6.

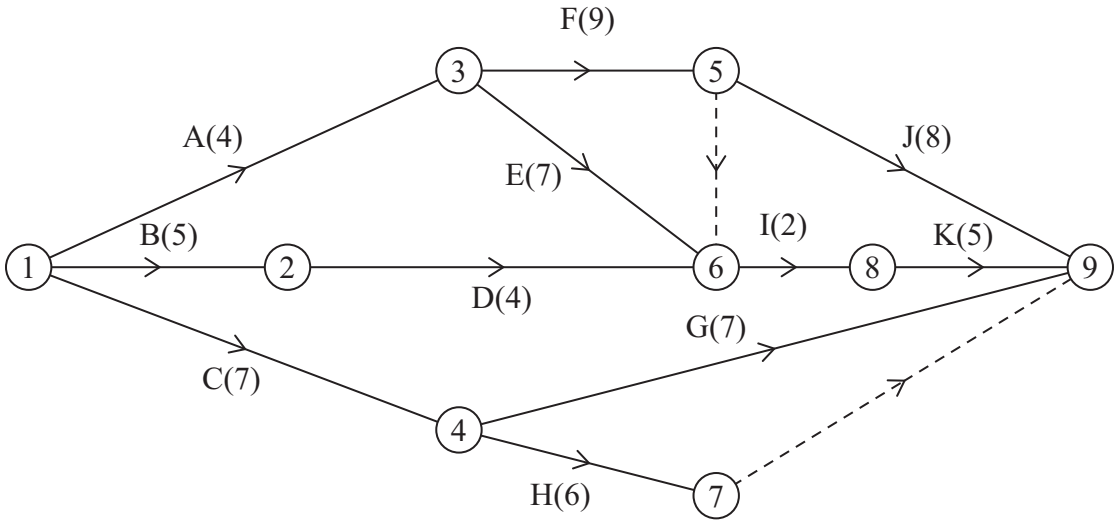

Figure 3

A project is modelled by the activity network shown in Figure 3. The activities are represented by the arcs. The number in brackets on each arc gives the time required, in hours, to complete the activity. The numbers in circles are the event numbers. Each activity requires one worker.

(a) Complete Diagram 1 in the answer book to show the early event times and the late event times.

(4)

(b) State the minimum project completion time.

(1)

(c) Calculate a lower bound for the minimum number of workers required to complete the project in the minimum time. You must show your working.

(2)

(d) On Grid 1 in your answer book, draw a cascade (Gantt) chart for this project.

(4)

(e) On Grid 2 in your answer book, construct a scheduling diagram to show that this project can be completed with three workers in just one more hour than the minimum project completion time.

(3)

(Total for Question 6 is 14 marks)

Question 6

Write the answer to Question 6 on these 2 pages

(a)

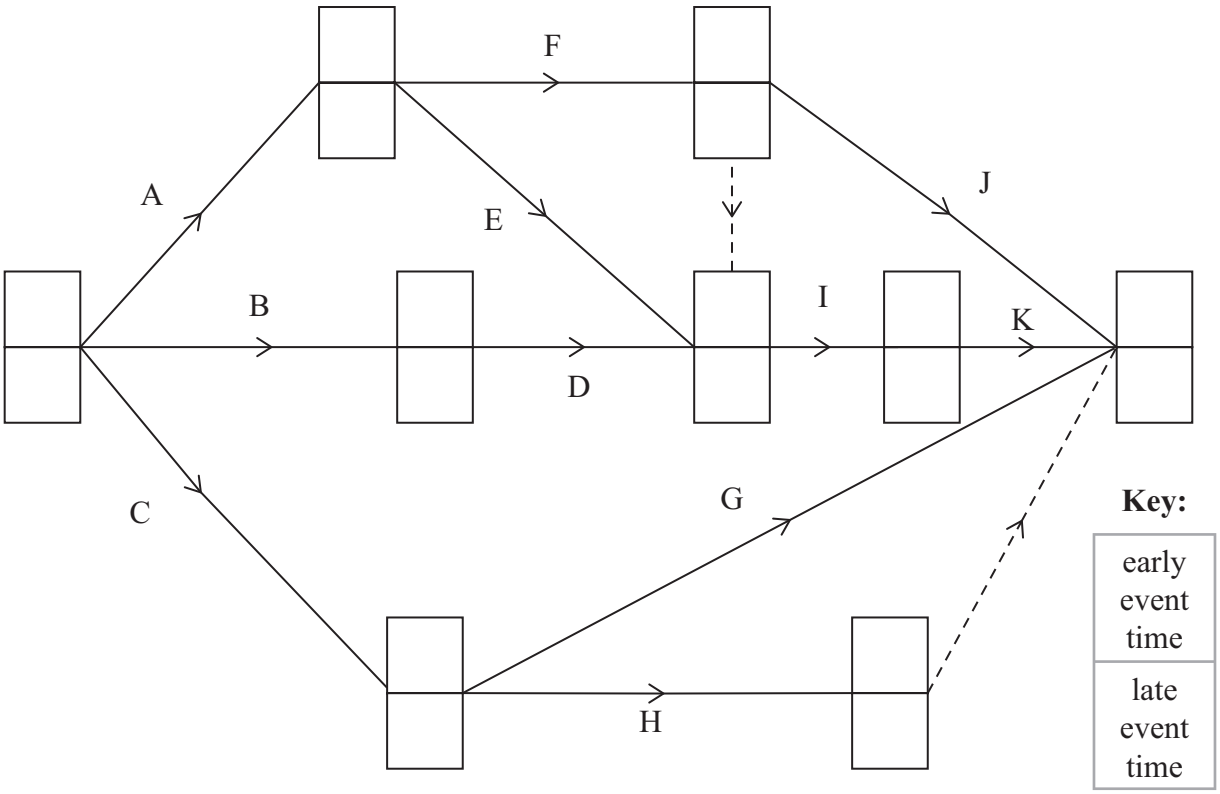

Diagram 1

(b)

(c)

DO NOT WRITE IN THIS AREA
DO NOT WRITE IN THIS AREA
DO NOT WRITE IN THIS AREA

Question 6 continued

(d)

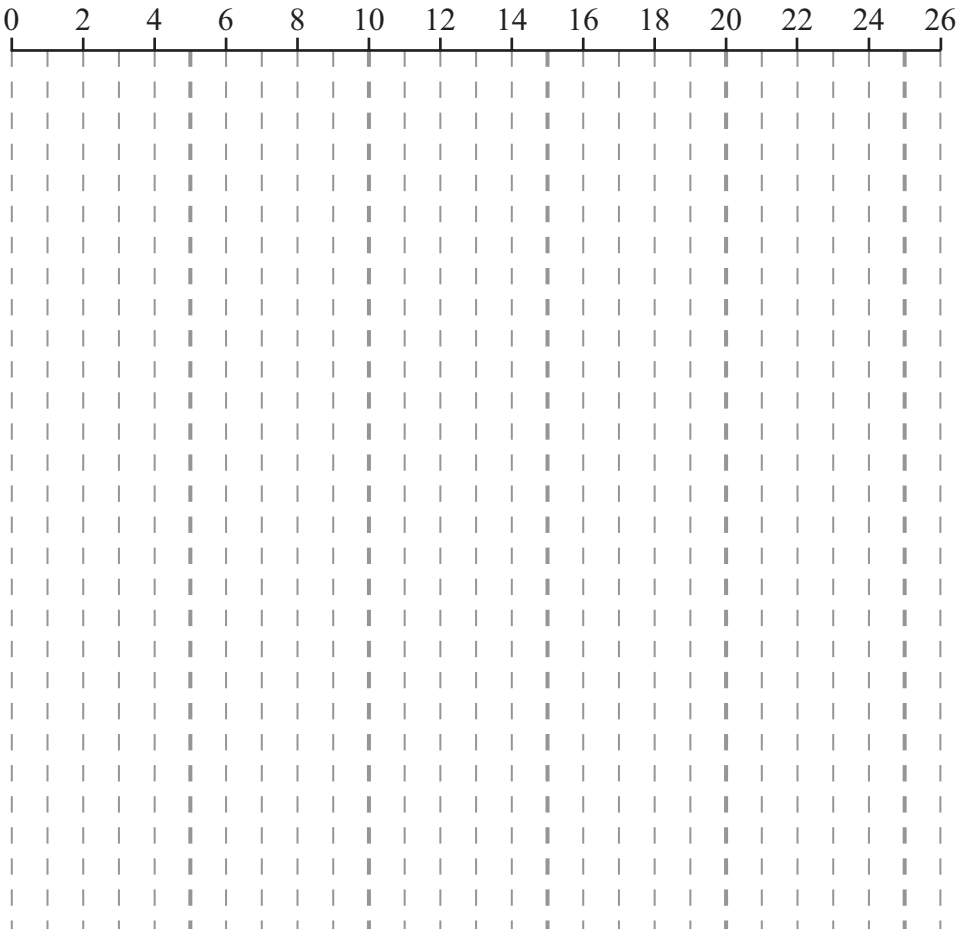

Grid 1

(e)



Grid 2

This is the end of Question 6 answer space. Please turn the page for Question 7 answer space.

(Total for Question 6 is 14 marks)

DO NOT WRITE IN THIS AREA
DO NOT WRITE IN THIS AREA
DO NOT WRITE IN THIS AREA